Completing and Matching Volume Equations

Name:

Match each problem with the equation that could represent it. Answer with the missing term and letter.

Ex)

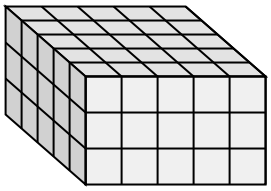

1)

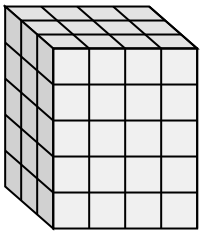

2)

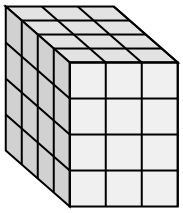

3)

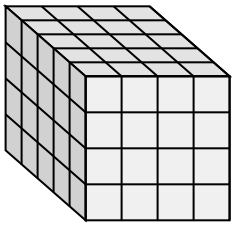

4)

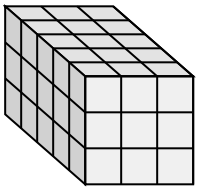

5)

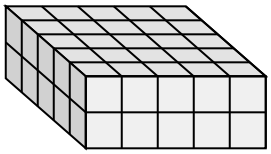

6)

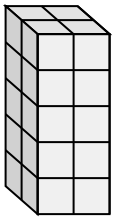

7)

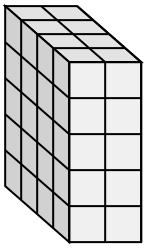

8)

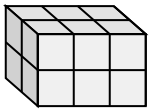

9)

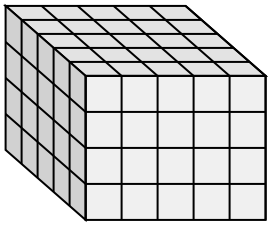

10)

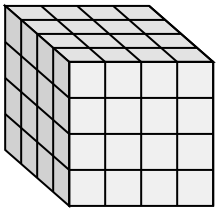

11)

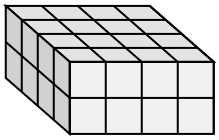

A. 5 × 5 × 2 = ___

B. 2 × 3 × ___ = 12

C. 4 × ___ × 4 = 48

D. 4 × 4 × ___ = 64

E. ___ × 3 × 3 = 45

F. 4 × ___ × 2 = 32

G. 4 × 2 × 5 = ___

H. 5 × 5 × ___ = 75

I. 3 × 4 × ___ = 60

J. 2 × ___ × 5 = 20

K. 5 × 5 × ___ = 100

L. ___ × 4 × 4 = 80

Answers

Ex.	H	3
1.		
2.		
3.		
4.		
5.		
6.		
7.		
8.		
9.		
10.		
11.		

Completing and Matching Volume Equations Name: **Answer Key**

Match each problem with the equation that could represent it. Answer with the missing term and letter.

Ex)

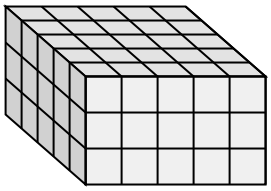

1)

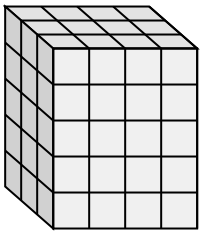

2)

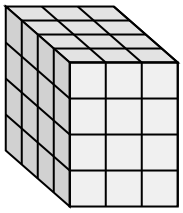

3)

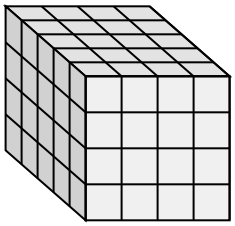

4)

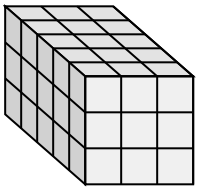

5)

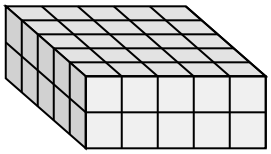

6)

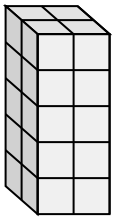

7)

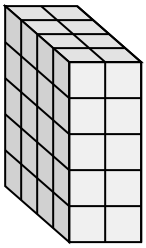

8)

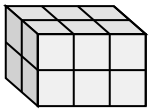

9)

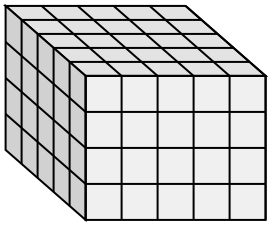

10)

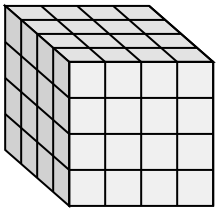

11)

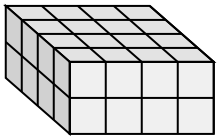

A. 5 × 5 × 2 = ___

B. 2 × 3 × ___ = 12

C. 4 × ___ × 4 = 48

D. 4 × 4 × ___ = 64

E. ___ × 3 × 3 = 45

F. 4 × ___ × 2 = 32

G. 4 × 2 × 5 = ___

H. 5 × 5 × ___ = 75

I. 3 × 4 × ___ = 60

J. 2 × ___ × 5 = 20

K. 5 × 5 × ___ = 100

L. ___ × 4 × 4 = 80

Answers

Ex.	H	3
1.	I	5
2.	C	3
3.	L	5
4.	E	5
5.	A	50
6.	J	2
7.	G	40
8.	B	2
9.	K	4
10.	D	4
11.	F	4